Name

Area of a Rectangle (sides below 10) - Image to Area

1 Find the area of this rectangle

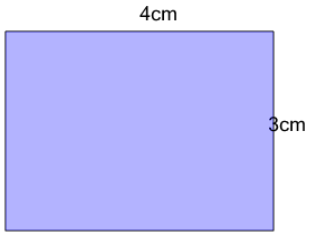

A	B	C
$14cm^2$	$40cm^2$	$7cm^2$
D	E	
$6cm^2$	$12cm^2$	

2 Find the area of this rectangle

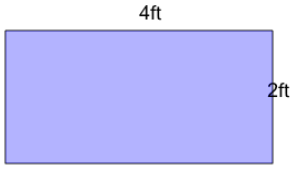

A	B	C
$4ft^2$	$6ft^2$	$8ft^2$

3 Find the area of this rectangle

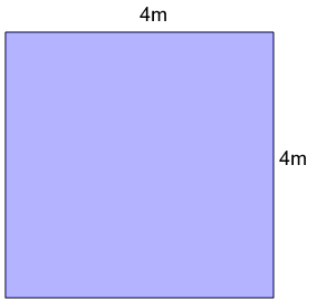

A	B	C
$8m^2$	$16m^2$	$35m^2$

4 Find the area of this rectangle

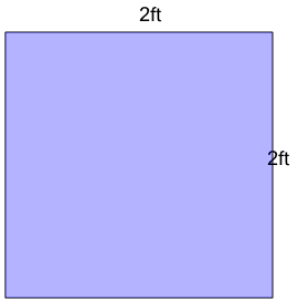

A	B	C
$9ft^2$	$20ft^2$	$4ft^2$

5 Find the area of this rectangle

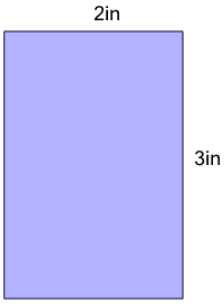

A	B	C
$6in^2$	$5in^2$	$10in^2$
D		
$4in^2$		

6 Find the area of this rectangle

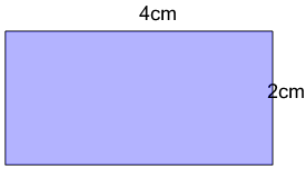

A	B	C
$4cm^2$	$32cm^2$	$8cm^2$
D	E	
$18cm^2$	$21cm^2$	

7 Find the area of this rectangle

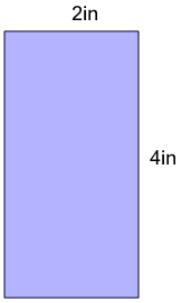

A	B	C
$4in^2$	$6in^2$	$12in^2$
D		
$8in^2$		

8 Find the area of this rectangle

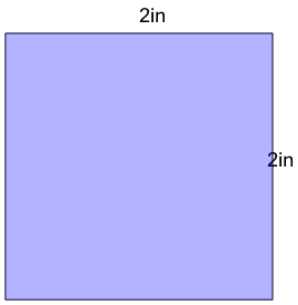

A	B	C
$4in^2$	$8in^2$	$20in^2$
D		
$24in^2$		