Name

Statistics - Histograms - Histogram to Frequency Table

1 Which frequency table matches this histogram?

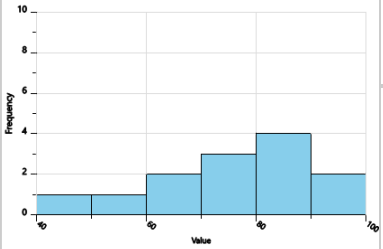

A

B

C

2 Which frequency table matches this histogram?

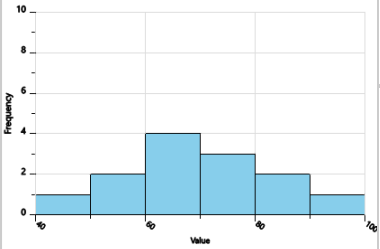

A

B

C

3 Which frequency table matches this histogram?

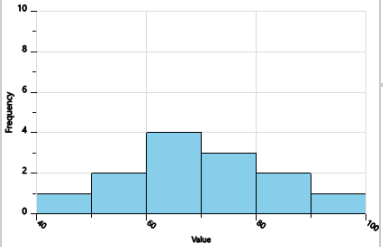

A

B

C

4 Which frequency table matches this histogram?

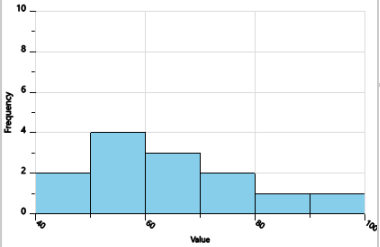

A

B

C

5 Which frequency table matches this histogram?

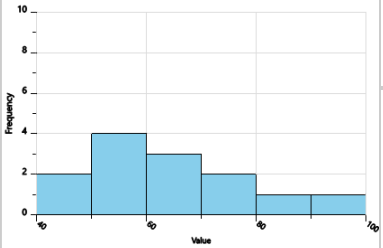

A

B

C

6 Which frequency table matches this histogram?

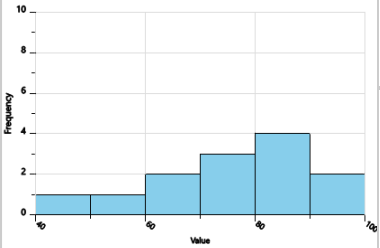

A

B

C

7 Which frequency table matches this histogram?

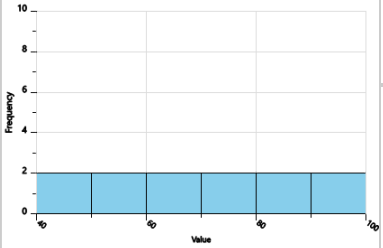

A

B

C

8 Which frequency table matches this histogram?

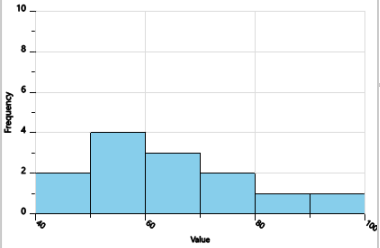

A

B

C